Skupiny obrázků, které k sobě patří

Nadřazené a podřazené pojmy
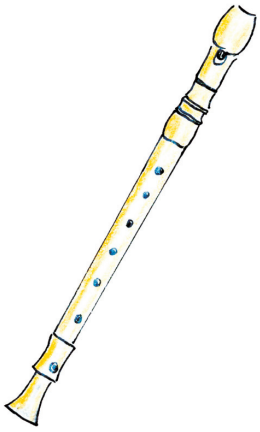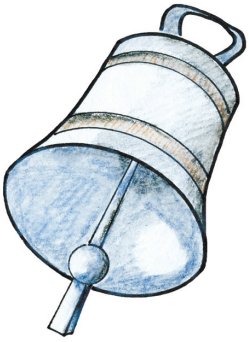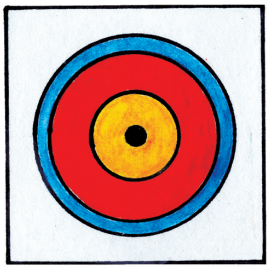
Poznáš, které obrázky k sobě patří a proč? Jak bys jejich skupinu nazval?
Nejdříve si je můžeš vystřihnout.
Na závěr můžeš u všech slov určit první a poslední hlásku a počet slabik.